Comparing lengths using centimeters

Grade 1 Measurement Worksheet

Measure the following objects and circle the shorter object.

Length: _____ centimeters



Length: _____ centimeters

Length: _____ centimeters

Length: _____ centimeters



Length: _____ centimeters



Length: _____ centimeters

Answers

Length: 4 centimeters



Length: 8 centimeters



Length: 3 centimeters

Length: 6 centimeters



Length: 5 centimeters



Length: 9 centimeters